Name : _____ Date : _____

Find the area of the rectangles below.

Example: 

Area = 3 × 1 = 3

1)

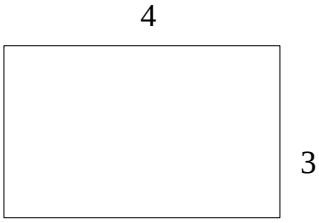

Area = _____

2)

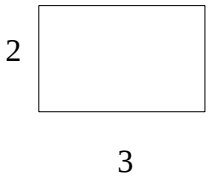

Area = _____

3)

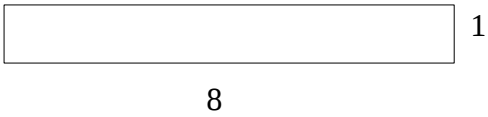

Area = _____

4)

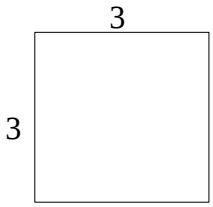

Area = _____

5)

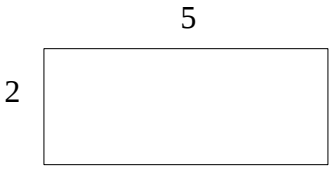

Area = _____

6)

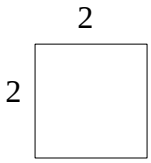

Area = _____